Edexcel (U.K.) Pre 2017

Questions By Topic

FP1 Chap03 Coordinate Systems

Compiled By: Dr Yu

Editors: Betül, Signal, Vivian

www.CasperYC.club

Last updated: February 10, 2026

CC BY NC ND

DrYuFromShanghai@QQ.com

Leave blank

3. The rectangular hyperbola, H, has parametric equations $x = 5t$, $y = \frac{5}{t}$, $t \neq 0$.

(a) Write the cartesian equation of H in the form $xy = c^2$.

(1)

Points A and B on the hyperbola have parameters $t = 1$ and $t = 5$ respectively.

(b) Find the coordinates of the mid-point of AB.

(3)

Leave blank

5. The parabola C has equation $y^2 = 20x$.

(a) Verify that the point $P(5t^2, 10t)$ is a general point on C.

(1)

The point A on C has parameter $t = 4$.
The line l passes through A and also passes through the focus of C.

(b) Find the gradient of l.

(4)

Leave blank

4.

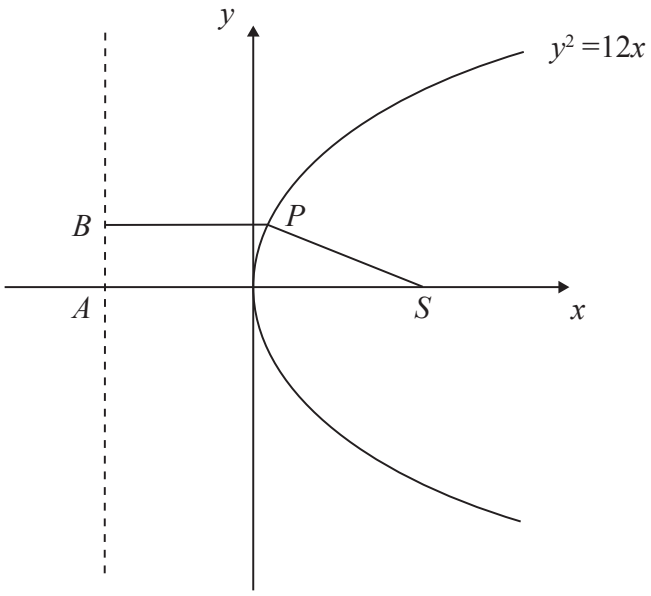

Figure 1

Figure 1 shows a sketch of part of the parabola with equation $y^2 = 12x$.

The point P on the parabola has x-coordinate $\frac{1}{3}$.

The point S is the focus of the parabola.

(a) Write down the coordinates of S.

(1)

The points A and B lie on the directrix of the parabola.
The point A is on the x-axis and the y-coordinate of B is positive.

Given that $ABPS$ is a trapezium,

(b) calculate the perimeter of $ABPS$.

(5)

Leave blank

5.

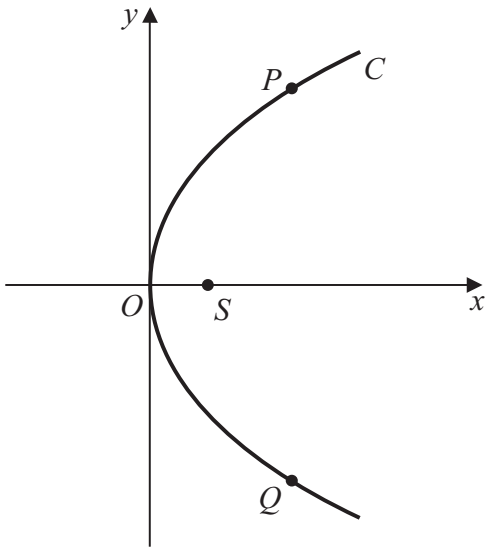

Figure 1

Figure 1 shows a sketch of the parabola C with equation $y^2 = 8x$.
The point P lies on C, where $y > 0$, and the point Q lies on C, where $y < 0$
The line segment PQ is parallel to the y-axis.

Given that the distance PQ is 12,

(a) write down the y-coordinate of P,

(1)

(b) find the x-coordinate of P.

(2)

Figure 1 shows the point S which is the focus of C.
The line l passes through the point P and the point S.

(c) Find an equation for l in the form $ax + by + c = 0$, where a, b and c are integers.

(4)

Leave blank

3. A parabola C has cartesian equation $y^2 = 16x$. The point $P\left(4t^2, 8t\right)$ is a general point on C.

(a) Write down the coordinates of the focus F and the equation of the directrix of C.

(3)

(b) Show that the equation of the normal to C at P is $y + tx = 8t + 4t^3$.

(5)

Leave blank

6.

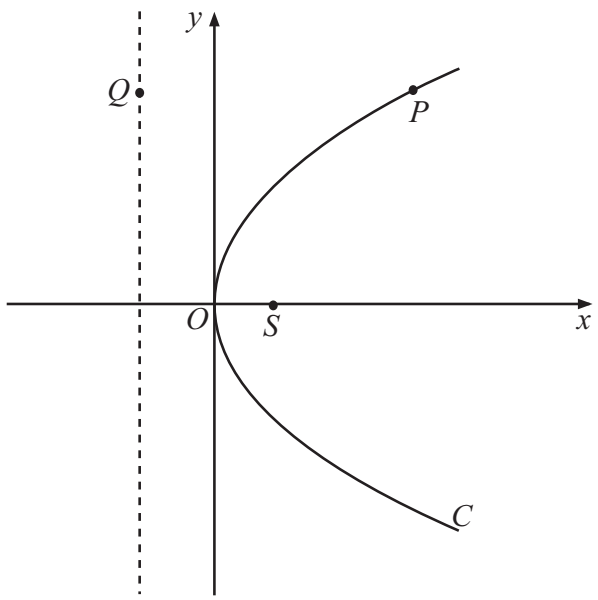

Figure 1

Figure 1 shows a sketch of the parabola C with equation $y^2 = 36x$.
The point S is the focus of C.

(a) Find the coordinates of S.

(1)

(b) Write down the equation of the directrix of C.

(1)

Figure 1 shows the point P which lies on C, where $y > 0$, and the point Q which lies on the directrix of C. The line segment QP is parallel to the x-axis.

Given that the distance PS is 25,

(c) write down the distance QP,

(1)

(d) find the coordinates of P,

(3)

(e) find the area of the trapezium $OSPQ$.

(2)

Leave blank

8. The rectangular hyperbola H has equation $xy = c^2$, where c is a positive constant.

The point $P\left(ct, \frac{c}{t}\right)$, $t \neq 0$, is a general point on H.

(a) Show that an equation for the tangent to H at P is

$$x + t^2y = 2ct$$

(4)

The tangent to H at the point P meets the x-axis at the point A and the y-axis at the point B.

Given that the area of the triangle OAB, where O is the origin, is 36,

(b) find the exact value of c, expressing your answer in the form $k\sqrt{2}$, where k is an integer.

(4)

Leave blank

7. The parabola C has equation $y^2 = 4ax$, where a is a positive constant.

The point $P(at^2, 2at)$ is a general point on C.

(a) Show that the equation of the tangent to C at $P(at^2, 2at)$ is

$$ty = x + at^2$$

(4)

The tangent to C at P meets the y-axis at a point Q.

(b) Find the coordinates of Q.

(1)

Given that the point S is the focus of C,

(c) show that PQ is perpendicular to SQ.

(3)

Leave blank

5.

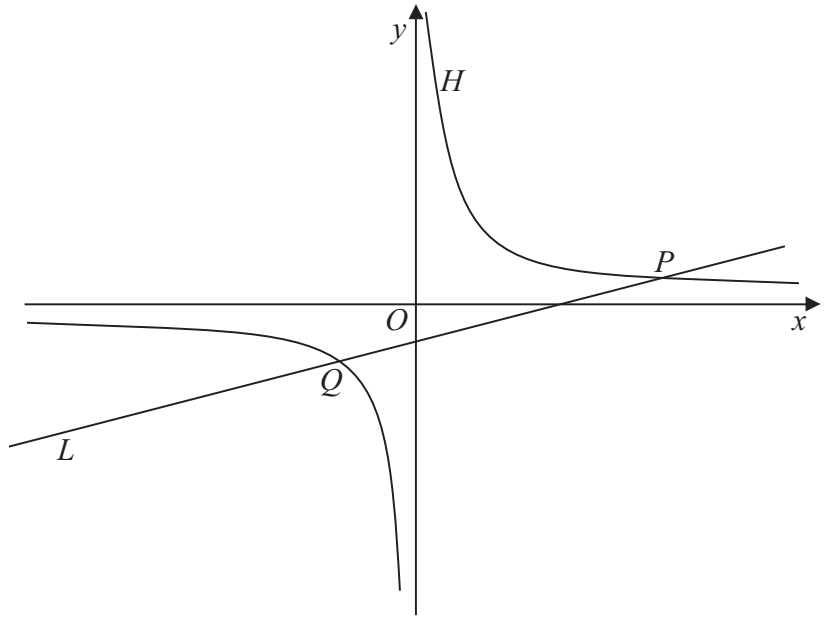

Figure 1

Figure 1 shows a rectangular hyperbola H with parametric equations

$$x = 3t, \quad y = \frac{3}{t}, \quad t \neq 0$$

The line L with equation $6y = 4x - 15$ intersects H at the point P and at the point Q as shown in Figure 1.

(a) Show that L intersects H where $4t^2 - 5t - 6 = 0$

(3)

(b) Hence, or otherwise, find the coordinates of points P and Q.

(5)

Leave blank

9.

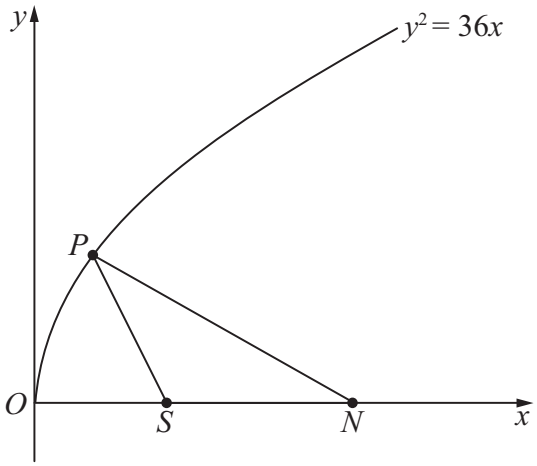

Figure 1

Figure 1 shows a sketch of part of the parabola with equation $y^2 = 36x$.

The point P (4, 12) lies on the parabola.

(a) Find an equation for the normal to the parabola at P.

(5)

This normal meets the x-axis at the point N and S is the focus of the parabola, as shown in Figure 1.

(b) Find the area of triangle PSN.

(4)

Leave blank

4. The rectangular hyperbola H has Cartesian equation $xy = 4$

The point $P\left(2t, \frac{2}{t}\right)$ lies on H, where $t \neq 0$

(a) Show that an equation of the normal to H at the point P is

$$ty - t^3x = 2 - 2t^4$$

(5)

The normal to H at the point where $t = -\frac{1}{2}$ meets H again at the point Q.

(b) Find the coordinates of the point Q.

(4)

Leave blank

7. The rectangular hyperbola H has equation $xy = c^2$, where c is a constant.

The point $P\left(ct, \frac{c}{t}\right)$ is a general point on H.

(a) Show that the tangent to H at P has equation

$$t^2 y + x = 2ct$$

(4)

The tangents to H at the points A and B meet at the point $(15c, -c)$.

(b) Find, in terms of c, the coordinates of A and B.

(5)

Leave blank

9. The rectangular hyperbola H has cartesian equation $xy = 9$

The points $P\left(3p, \frac{3}{p}\right)$ and $Q\left(3q, \frac{3}{q}\right)$ lie on H, where $p \neq \pm q$.

(a) Show that the equation of the tangent at P is $x + p^2 y = 6p$.

(4)

(b) Write down the equation of the tangent at Q.

(1)

The tangent at the point P and the tangent at the point Q intersect at R.

(c) Find, as single fractions in their simplest form, the coordinates of R in terms of p and q.

(4)

Leave blank

8. The parabola C has equation $y^2 = 48x$.

The point $P\left(12t^2, 24t\right)$ is a general point on C.

(a) Find the equation of the directrix of C.

(2)

(b) Show that the equation of the tangent to C at $P\left(12t^2, 24t\right)$ is

$$x - ty + 12t^2 = 0$$

(4)

The tangent to C at the point $(3, 12)$ meets the directrix of C at the point X.

(c) Find the coordinates of X.

(4)

Leave blank

8. A parabola has equation $y^2 = 4ax$, $a > 0$. The point Q $(aq^2, 2aq)$ lies on the parabola.

(a) Show that an equation of the tangent to the parabola at Q is

$$yq = x + aq^2.$$

(4)

This tangent meets the y-axis at the point R.

(b) Find an equation of the line l which passes through R and is perpendicular to the tangent at Q.

(3)

(c) Show that l passes through the focus of the parabola.

(1)

(d) Find the coordinates of the point where l meets the directrix of the parabola.

(2)

Leave blank

6. The parabola C has equation $y^2 = 16x$.

(a) Verify that the point $P(4t^2, 8t)$ is a general point on C.

(1)

(b) Write down the coordinates of the focus S of C.

(1)

(c) Show that the normal to C at P has equation

$$y + tx = 8t + 4t^3$$

(5)

The normal to C at P meets the x-axis at the point N.

(d) Find the area of triangle PSN in terms of t, giving your answer in its simplest form.

(4)

Leave blank

6. A parabola C has equation $y^2 = 4ax, \quad a > 0$

The points $P(ap^2, 2ap)$ and $Q(aq^2, 2aq)$ lie on C, where $p \neq 0$, $q \neq 0$, $p \neq q$.

(a) Show that an equation of the tangent to the parabola at P is

$$py - x = ap^2$$

(4)

(b) Write down the equation of the tangent at Q.

(1)

The tangent at P meets the tangent at Q at the point R.

(c) Find, in terms of p and q, the coordinates of R, giving your answers in their simplest form.

(4)

Given that R lies on the directrix of C,

(d) find the value of pq.

(2)

Leave blank

8. The rectangular hyperbola H has equation $xy = c^2$, where c is a positive constant.

The point A on H has x-coordinate $3c$.

(a) Write down the y-coordinate of A.

(1)

(b) Show that an equation of the normal to H at A is

$$3y = 27x - 80c$$

(5)

The normal to H at A meets H again at the point B.

(c) Find, in terms of c, the coordinates of B.

(5)

Leave blank

10. The point $P\left(6t, \frac{6}{t}\right), t \neq 0$, lies on the rectangular hyperbola H with equation $xy = 36$.

(a) Show that an equation for the tangent to H at P is

$$y = -\frac{1}{t^2}x + \frac{12}{t}$$

(5)

The tangent to H at the point A and the tangent to H at the point B meet at the point $(-9, 12)$.

(b) Find the coordinates of A and B.

(7)

Leave blank

7. The rectangular hyperbola, H, has cartesian equation $xy = 25$

The point $P\left(5p, \frac{5}{p}\right)$, and the point $Q\left(5q, \frac{5}{q}\right)$, where $p, q \neq 0, p \neq q$, are points on the rectangular hyperbola H.

(a) Show that the equation of the tangent at point P is

$$p^2y + x = 10p$$

(4)

(b) Write down the equation of the tangent at point Q.

(1)

The tangents at P and Q meet at the point N.

Given $p + q \neq 0$,

(c) show that point N has coordinates $\left(\frac{10pq}{p+q}, \frac{10}{p+q}\right)$.

(4)

The line joining N to the origin is perpendicular to the line PQ.

(d) Find the value of p^2q^2.

(5)